Finding Angles within Shapes

Name:

Count the number of Acute, Obtuse and Right angles inside each shape.

Ex)

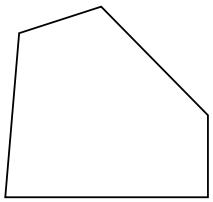

1)



2)

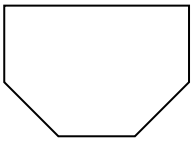

3)

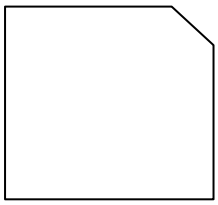

4)

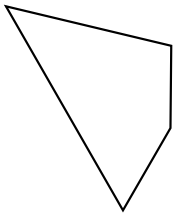

5)

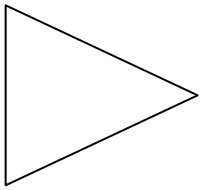

6)

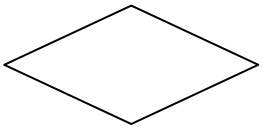

7)



8)

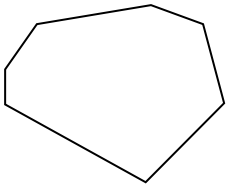

9)

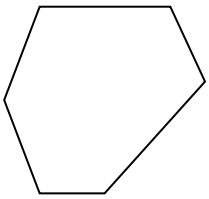

10)

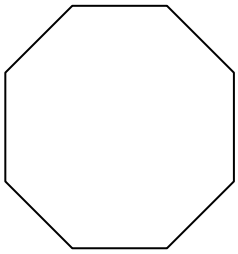

11)

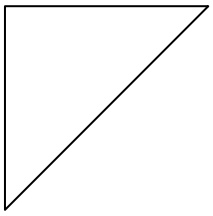

Answers

Ex.	1	3	1
1.			
2.			
3.			
4.			
5.			
6.			
7.			
8.			
9.			
10.			
11.			

1-10	91	82	73	64	55	45	36	27	18	9
11	0									

Finding Angles within Shapes

Name: **Answer Key**

Count the number of Acute, Obtuse and Right angles inside each shape.

Ex)

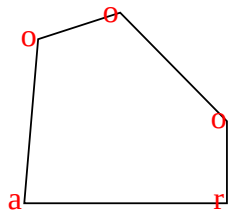

1)

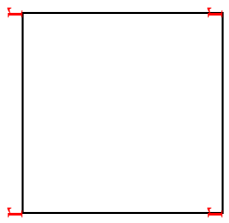

2)

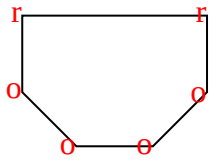

3)

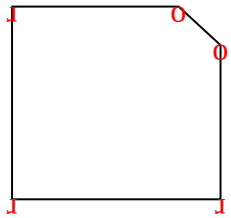

4)

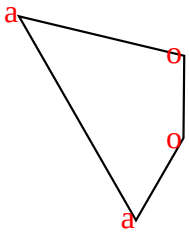

5)

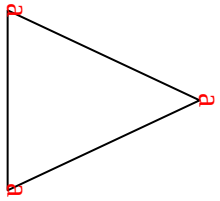

6)

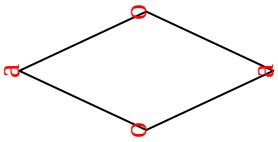

7)



8)

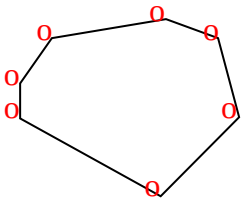

9)

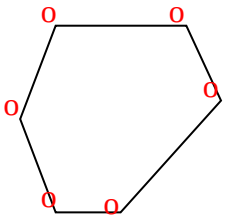

10)

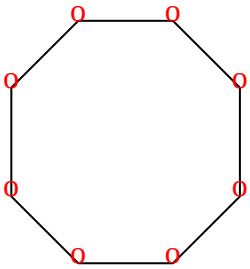

11)

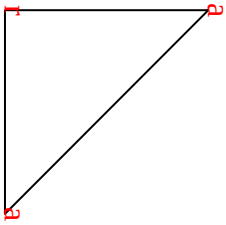

Answers

Ex.	1	3	1
1.	0	0	4
2.	0	4	2
3.	0	2	3
4.	2	2	0
5.	3	0	0
6.	2	2	0
7.	0	0	4
8.	0	7	0
9.	0	6	0
10.	0	8	0
11.	2	0	1

1-10	91	82	73	64	55	45	36	27	18	9
11	0									