Finding Angles within Shapes

Name:

Count the number of Acute, Obtuse, Right and Reflex angles in each shape.

Ex)

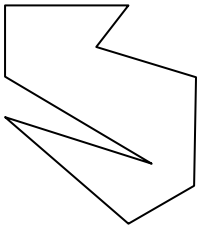

1)

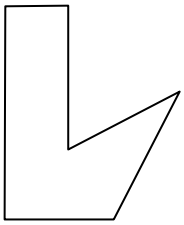

2)

3)



4)

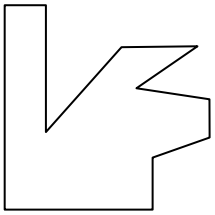

5)

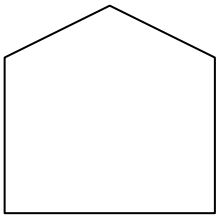

6)

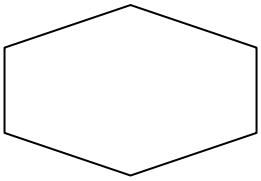

7)

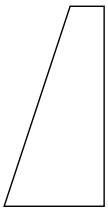

8)



9)

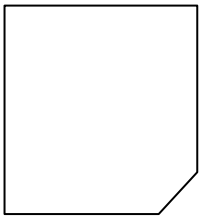

10)

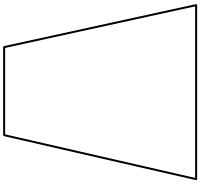

11)



Answers

Ex.	2	4	1	2
1.				
2.				
3.				
4.				
5.				
6.				
7.				
8.				
9.				
10.				
11.				

Finding Angles within Shapes

Name: **Answer Key**

Count the number of Acute, Obtuse, Right and Reflex angles in each shape.

Ex)

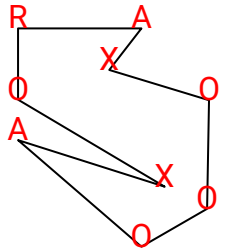

1)

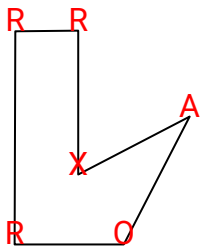

2)



3)

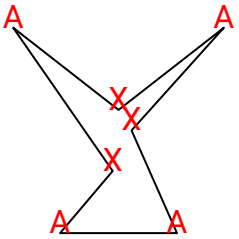

4)

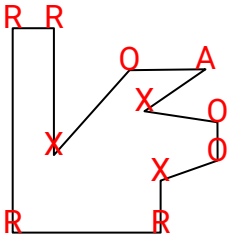

5)

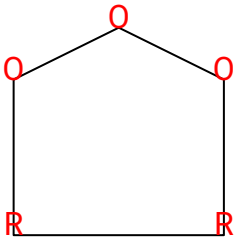

6)

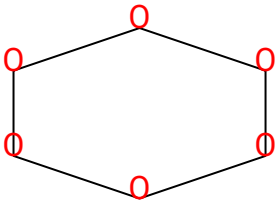

7)

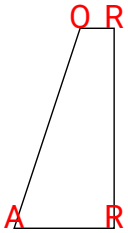

8)

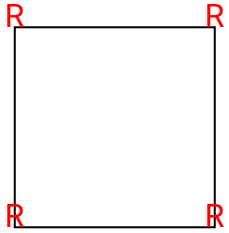

9)

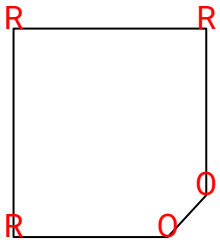

10)

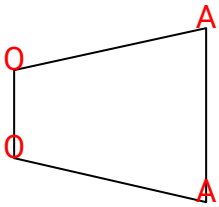

11)

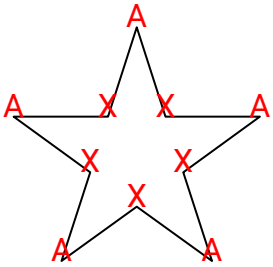

Answers

Ex.	2	4	1	2
1.	1	1	3	1
2.	0	0	4	0
3.	4	0	0	3
4.	1	3	4	3
5.	0	3	2	0
6.	0	0	6	0
7.	1	1	2	0
8.	0	0	4	0
9.	0	2	3	0
10.	2	2	0	0
11.	5	0	0	5