Completing and Matching Volume Equations

Name:

Match each problem with the equation that could represent it. Answer with the missing term and letter.

Ex) 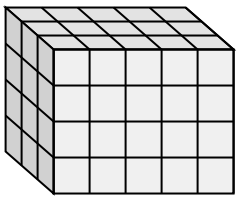

1) 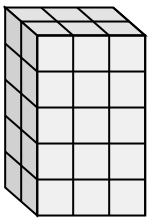

2) 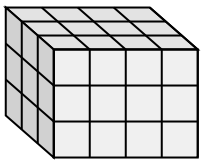

3) 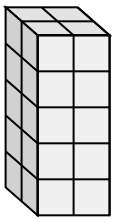

4) 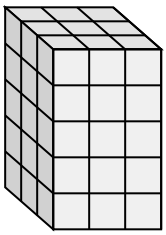

5) 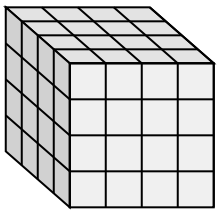

6) 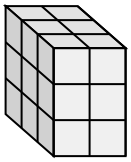

7) 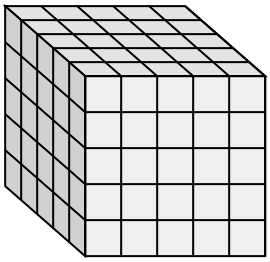

8) 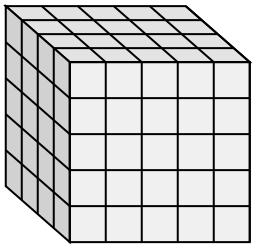

9) 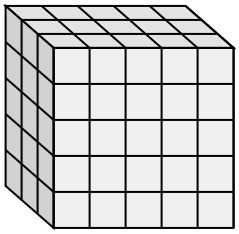

10) 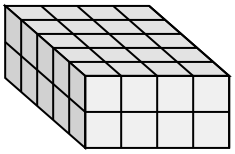

11) 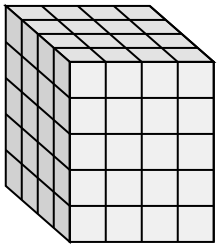

A. 3 × 5 × 4 = ___

B. 5 × ___ × 5 = 125

C. 2 × 2 × ___ = 20

D. ___ × 4 × 3 = 36

E. 5 × 4 × 2 = ___

F. ___ × 4 × 5 = 80

G. 3 × 3 × 5 = ___

H. 4 × 4 × 4 = ___

I. ___ × 5 × 5 = 75

J. 2 × ___ × 5 = 30

K. ___ × 5 × 5 = 100

L. 3 × 2 × 3 = ___

Answers

Ex. A , 60

1. _____
2. _____
3. _____
4. _____
5. _____
6. _____
7. _____
8. _____
9. _____
10. _____
11. _____

Completing and Matching Volume Equations Name: **Answer Key**

Match each problem with the equation that could represent it. Answer with the missing term and letter.

Ex) 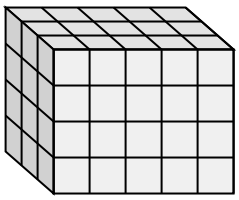

1) 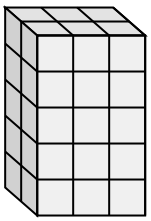

2) 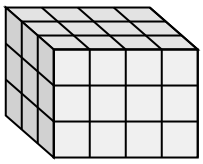

3) 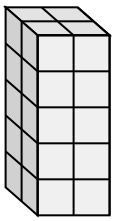

4) 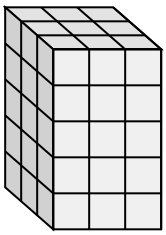

5) 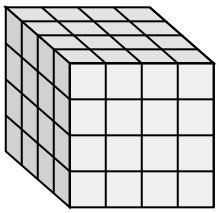

6) 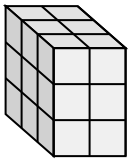

7) 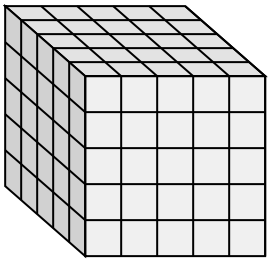

8) 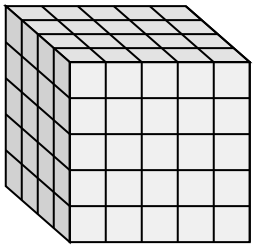

9) 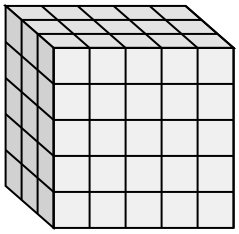

10) 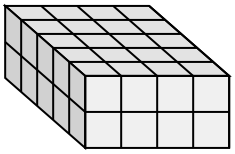

11) 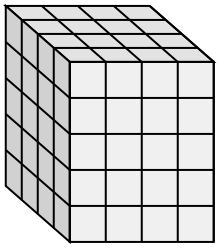

A. 3 × 5 × 4 = ___

B. 5 × ___ × 5 = 125

C. 2 × 2 × ___ = 20

D. ___ × 4 × 3 = 36

E. 5 × 4 × 2 = ___

F. ___ × 4 × 5 = 80

G. 3 × 3 × 5 = ___

H. 4 × 4 × 4 = ___

I. ___ × 5 × 5 = 75

J. 2 × ___ × 5 = 30

K. ___ × 5 × 5 = 100

L. 3 × 2 × 3 = ___

Answers

Ex.	A , 60
1.	J , 3
2.	D , 3
3.	C , 5
4.	G , 45
5.	H , 64
6.	L , 18
7.	B , 5
8.	K , 4
9.	I , 3
10.	E , 40
11.	F , 4