Dividing with a Numberline

Name:

Use the numberline to solve each problem.

1) 16÷4=

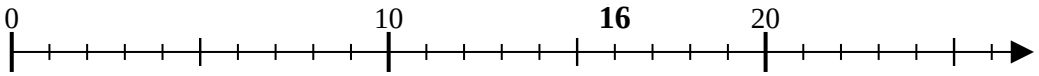

2) 36÷9=

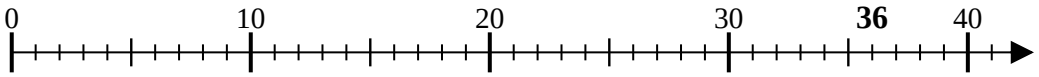

3) 28÷7=

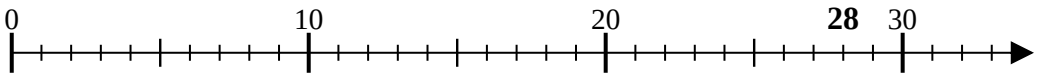

4) 20÷5=

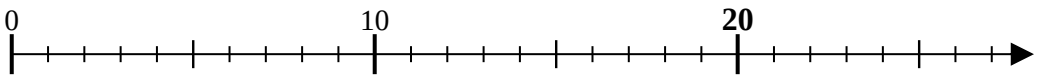

5) 10÷5=

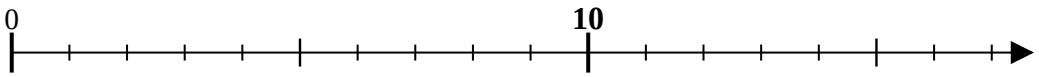

6) 14÷7=

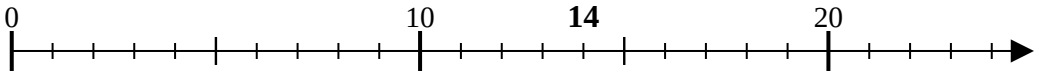

7) 12÷6=

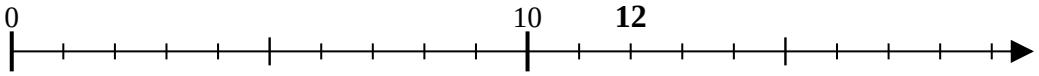

8) 32÷8=

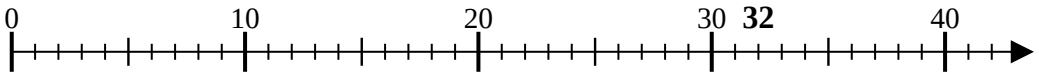

9) 15÷5=

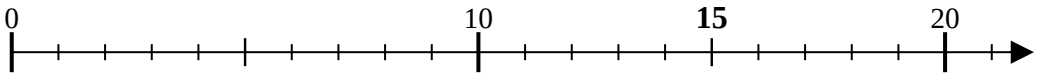

10) 25÷5=

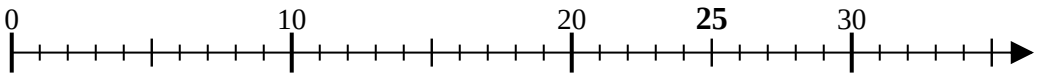

11) 45÷9=

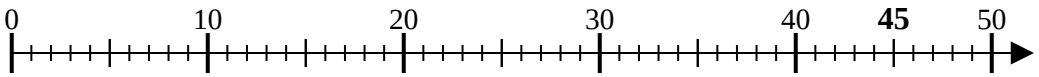

Answers

1. _____
2. _____
3. _____
4. _____
5. _____
6. _____
7. _____
8. _____
9. _____
10. _____
11. _____

1-10	91	82	73	64	55	45	36	27	18	9
11	0									

Dividing with a Numberline

Name: **Answer Key**

Use the numberline to solve each problem.

1) 16÷4=

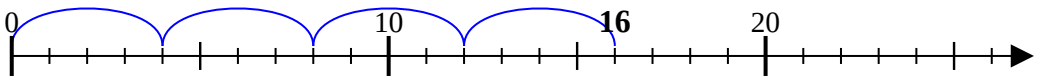

2) 36÷9=

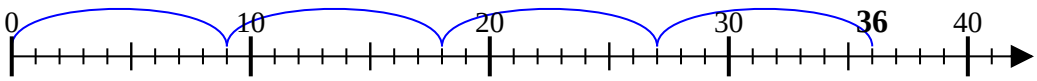

3) 28÷7=

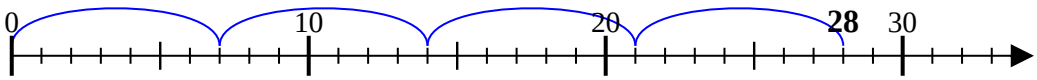

4) 20÷5=

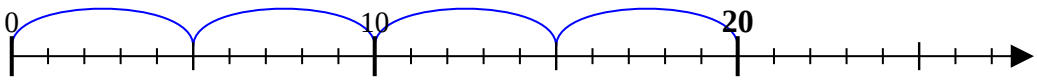

5) 10÷5=

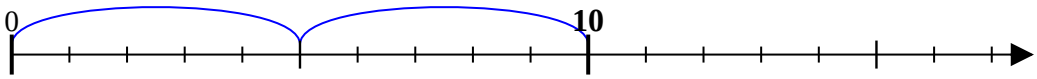

6) 14÷7=

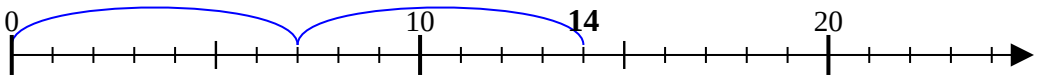

7) 12÷6=

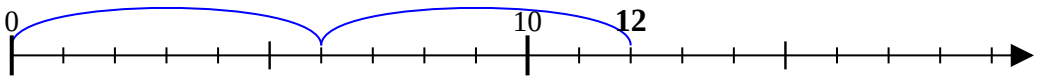

8) 32÷8=

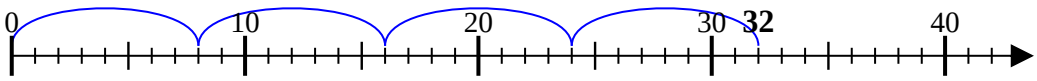

9) 15÷5=

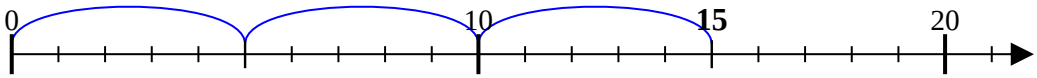

10) 25÷5=

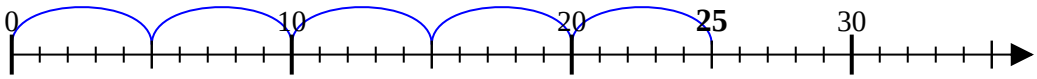

11) 45÷9=

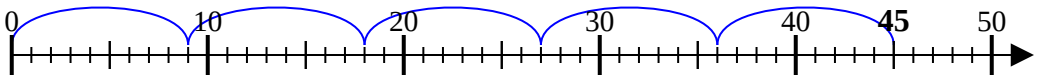

Answers

1. 4
2. 4
3. 4
4. 4
5. 2
6. 2
7. 2
8. 4
9. 3
10. 5
11. 5

1-10	91	82	73	64	55	45	36	27	18	9
11	0									