Fraction, Decimal & Percent (Visual)

Name:

Determine the value written as a fraction , decimal & a percent.

Ex)

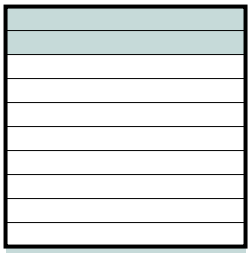

fraction $\frac{4}{10}$
decimal 0.4
percent 40

1)

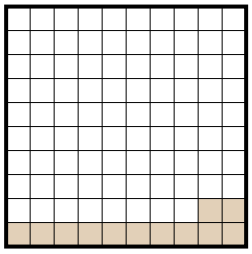

fraction
decimal
percent

2)

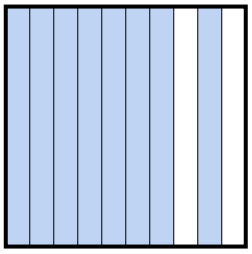

fraction
decimal
percent

3)

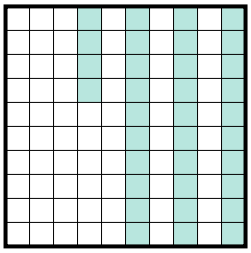

fraction
decimal
percent

4)

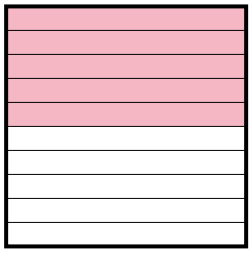

fraction
decimal
percent

5)

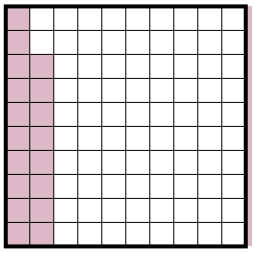

fraction
decimal
percent

6)

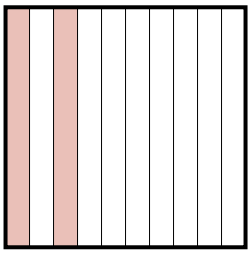

fraction
decimal
percent

7)

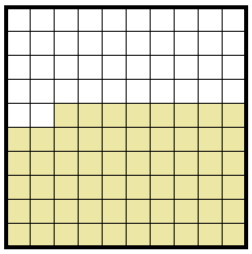

fraction
decimal
percent

8)



fraction
decimal
percent

9)

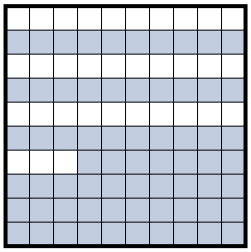

fraction
decimal
percent

10)

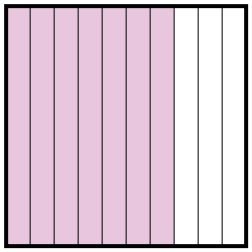

fraction
decimal
percent

11)

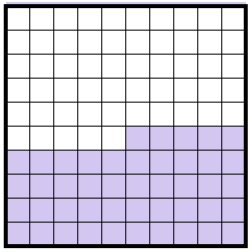

fraction
decimal
percent

Answers

Ex.	$\frac{4}{10}$	0.4	40%
1.			
2.			
3.			
4.			
5.			
6.			
7.			
8.			
9.			
10.			
11.			

Fraction, Decimal & Percent (Visual)

Name: **Answer Key**

Determine the value written as a fraction , decimal & a percent.

Ex)

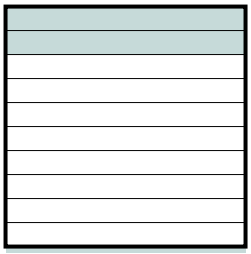

fraction $\frac{4}{10}$
decimal 0.4
percent 40

1)

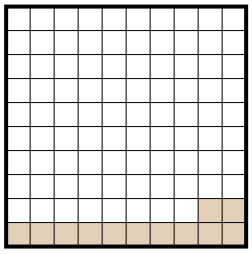

fraction $\frac{12}{100}$
decimal 0.12
percent 12

2)

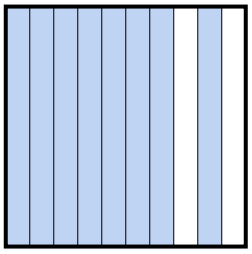

fraction $\frac{8}{10}$
decimal 0.8
percent 80

3)

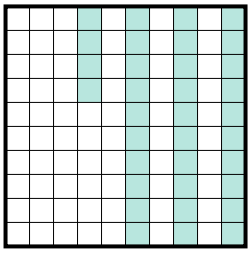

fraction $\frac{34}{100}$
decimal 0.34
percent 34

4)

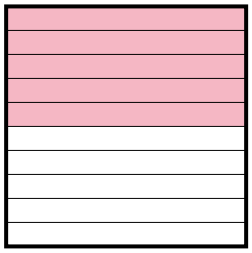

fraction $\frac{5}{10}$
decimal 0.5
percent 50

5)

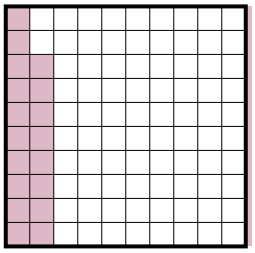

fraction $\frac{28}{100}$
decimal 0.28
percent 28

6)

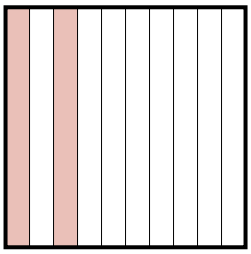

fraction $\frac{2}{10}$
decimal 0.2
percent 20

7)

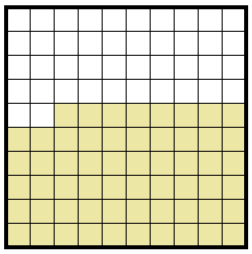

fraction $\frac{58}{100}$
decimal 0.58
percent 58

8)



fraction $\frac{9}{10}$
decimal 0.9
percent 90

9)

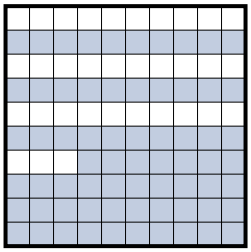

fraction $\frac{67}{100}$
decimal 0.67
percent 67

10)

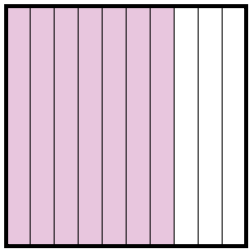

fraction $\frac{7}{10}$
decimal 0.7
percent 70

11)

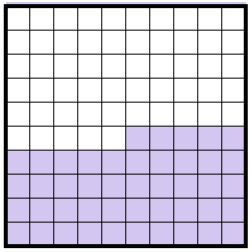

fraction $\frac{85}{100}$
decimal 0.85
percent 85

Answers

Ex.	$\frac{4}{10}$	0.4	40%
1.	$\frac{12}{100}$	0.12	12%
2.	$\frac{8}{10}$	0.8	80%
3.	$\frac{34}{100}$	0.34	34%
4.	$\frac{5}{10}$	0.5	50%
5.	$\frac{28}{100}$	0.28	28%
6.	$\frac{2}{10}$	0.2	20%
7.	$\frac{58}{100}$	0.58	58%
8.	$\frac{9}{10}$	0.9	90%
9.	$\frac{67}{100}$	0.67	67%
10.	$\frac{7}{10}$	0.7	70%
11.	$\frac{85}{100}$	0.85	85%