# Fraction Quantity Relative to Whole

Name:

**Solve each problem.**

**Ex)** Express the triangles as a fraction of the entire set.

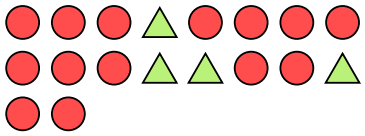

**1)** Express the moons as a fraction of the entire set.



**2)** Express the circles as a fraction of the entire set.

**3)** Express the squares as a fraction of the entire set.

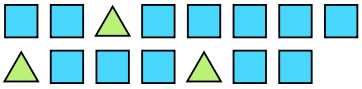

**4)** Express the triangles as a fraction of the entire set.

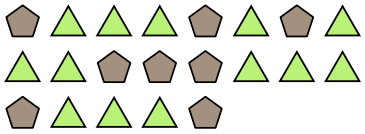

**5)** Express the triangles as a fraction of the entire set.

**6)** Express the moons as a fraction of the entire set.

**7)** Express the circles as a fraction of the entire set.



**8)** Express the moons as a fraction of the entire set.

**9)** Express the stars as a fraction of the entire set.

**10)** Express the circles as a fraction of the entire set.



**11)** Express the pentagons as a fraction of the entire set.

## Answers

Ex. 4/18

1. _____
2. _____
3. _____
4. _____
5. _____
6. _____
7. _____
8. _____
9. _____
10. _____
11. _____



| | | | | | | | | | | |
|---|---|---|---|---|---|---|---|---|---|---|
| 1-10 | 91 | 82 | 73 | 64 | 55 | 45 | 36 | 27 | 18 | 9 |
| 11 | 0 | | | | | | | | | |

Fraction Quantity Relative to Whole

Name: **Answer Key**

**Solve each problem.**

**Ex)** Express the triangles as a fraction of the entire set.

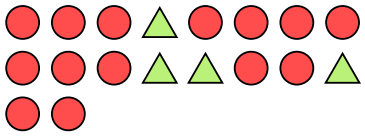

**1)** Express the moons as a fraction of the entire set.



**2)** Express the circles as a fraction of the entire set.

**3)** Express the squares as a fraction of the entire set.

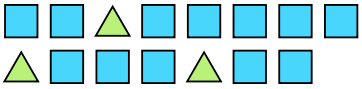

**4)** Express the triangles as a fraction of the entire set.

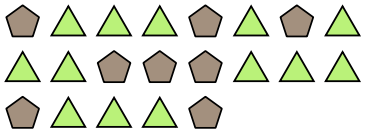

**5)** Express the triangles as a fraction of the entire set.

**6)** Express the moons as a fraction of the entire set.

**7)** Express the circles as a fraction of the entire set.



**8)** Express the moons as a fraction of the entire set.

**9)** Express the stars as a fraction of the entire set.

**10)** Express the circles as a fraction of the entire set.



**11)** Express the pentagons as a fraction of the entire set.

## Answers

| | |
|---|---|
| Ex. | 4/18 |
| 1. | 15/23 |
| 2. | 9/16 |
| 3. | 12/15 |
| 4. | 13/21 |
| 5. | 4/14 |
| 6. | 5/9 |
| 7. | 11/23 |
| 8. | 7/12 |
| 9. | 6/19 |
| 10. | 8/23 |
| 11. | 2/5 |



| | | | | | | | | | | |
|---|---|---|---|---|---|---|---|---|---|---|
| 1-10 | 91 | 82 | 73 | 64 | 55 | 45 | 36 | 27 | 18 | 9 |
| 11 | 0 | | | | | | | | | |