Improper and Mixed Fractions Visual

Name:

Write each amount as a mixed number.

1)

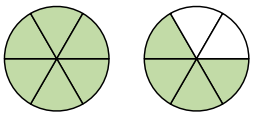

2)

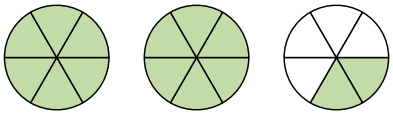

3)

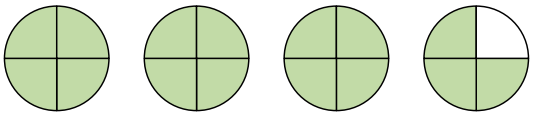

4)

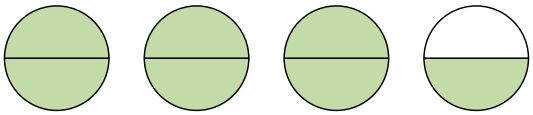

5)

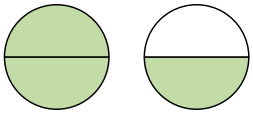

Write each amount as an improper fraction.

6)

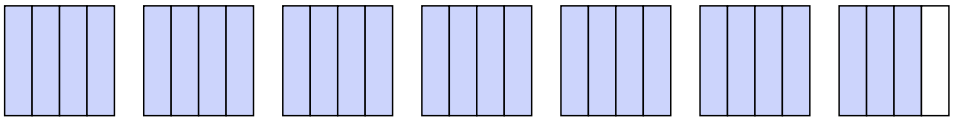

7)

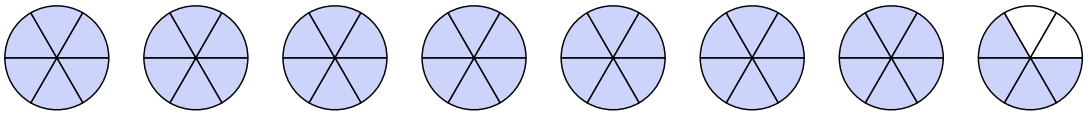

8)

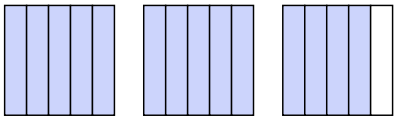

9)

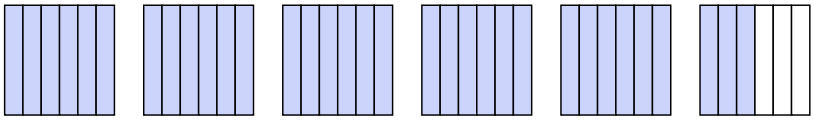

10)

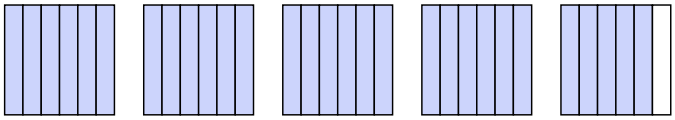

11)

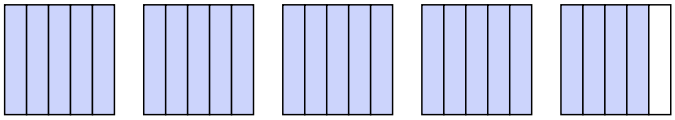

Answers

1. _____
2. _____
3. _____
4. _____
5. _____
6. _____
7. _____
8. _____
9. _____
10. _____
11. _____

Improper and Mixed Fractions Visual

Name: **Answer Key**

Write each amount as a mixed number.

1)

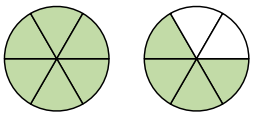

2)

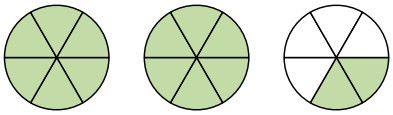

3)

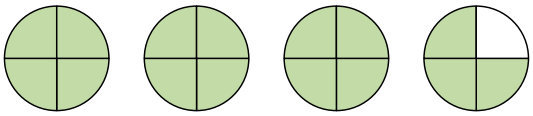

4)

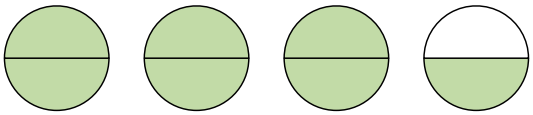

5)

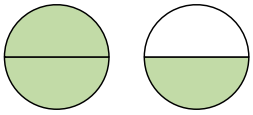

Write each amount as an improper fraction.

6)

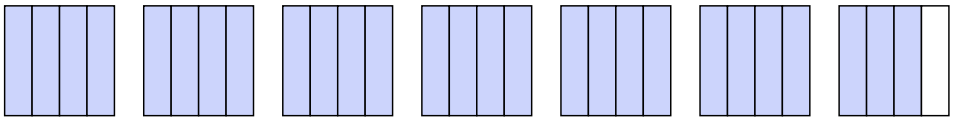

7)

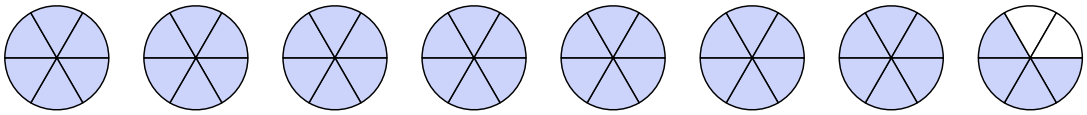

8)

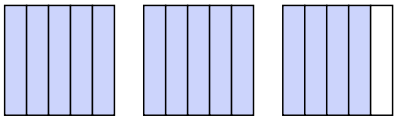

9)

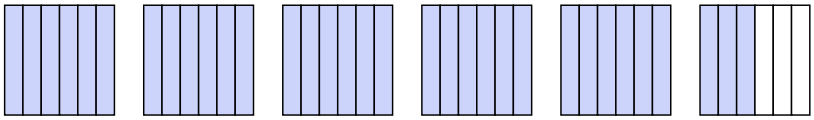

10)

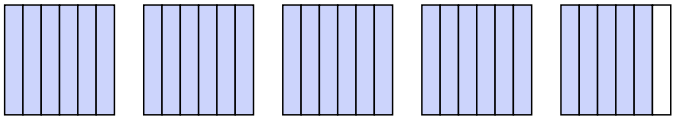

11)

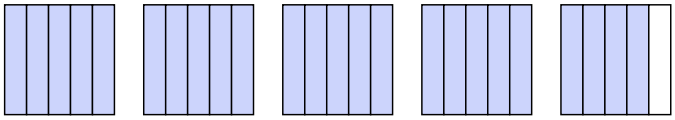

Answers

1. $1\frac{4}{6}$
2. $2\frac{2}{6}$
3. $3\frac{3}{4}$
4. $3\frac{1}{2}$
5. $1\frac{1}{2}$
6. $\frac{27}{4}$
7. $\frac{46}{6}$
8. $\frac{14}{5}$
9. $\frac{33}{6}$
10. $\frac{29}{6}$
11. $\frac{24}{5}$

1-10	91	82	73	64	55	45	36	27	18	9
11	0									