# Rewriting Multiplication Problems (visual)

Name:

**Write each array as a multiplication problem and solve.**

**Ex)**



**1)**

**2)**



**3)**

**4)**



**5)**



**6)**



**7)**



**8)**



**9)**

**10)**



**11)**

## Answers

Ex. 7 × 7 = 49

1. _____
2. _____
3. _____
4. _____
5. _____
6. _____
7. _____
8. _____
9. _____
10. _____
11. _____



| | | | | | | | | | | |
|---|---|---|---|---|---|---|---|---|---|---|
| 1-10 | 91 | 82 | 73 | 64 | 55 | 45 | 36 | 27 | 18 | 9 |
| 11 | 0 | | | | | | | | | |

Rewriting Multiplication Problems (visual) Name: **Answer Key**

**Write each array as a multiplication problem and solve.**

**Ex)**



**1)**

**2)**



**3)**

**4)**



**5)**



**6)**



**7)**



**8)**



**9)**

**10)**



**11)**

## Answers

Ex. 7 × 7 = 49

1. 8 × 6 = 48

2. 6 × 8 = 48

3. 5 × 2 = 10

4. 10 × 8 = 80

5. 8 × 2 = 16

6. 9 × 10 = 90

7. 3 × 8 = 24

8. 8 × 9 = 72

9. 3 × 9 = 27

10. 9 × 9 = 81

11. 6 × 4 = 24



| | | | | | | | | | | |
|---|---|---|---|---|---|---|---|---|---|---|
| 1-10 | 91 | 82 | 73 | 64 | 55 | 45 | 36 | 27 | 18 | 9 |
| 11 | 0 | | | | | | | | | |