Function Machines (Add & Subtract)

Name:

Determine the rule each function machine is using.

Ex)

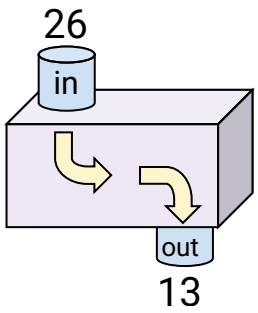

Subtract 13

1)

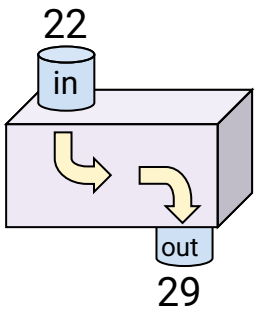

2)

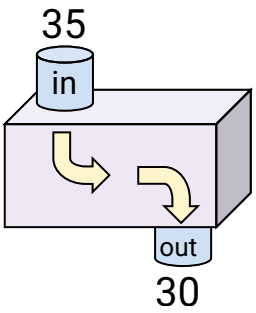

3)

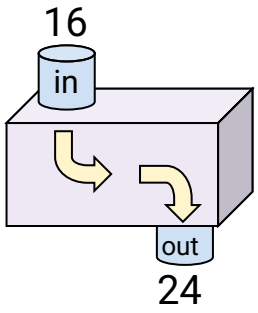

4)

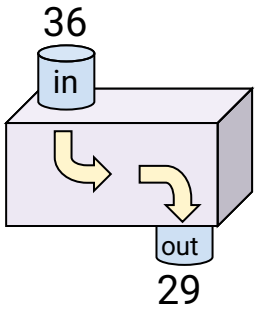

5)

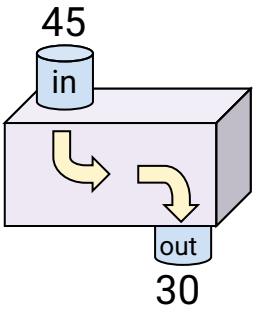

6)

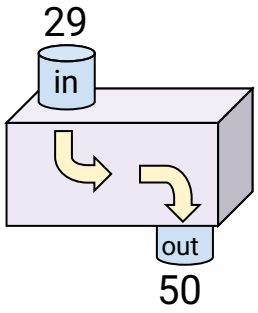

7)

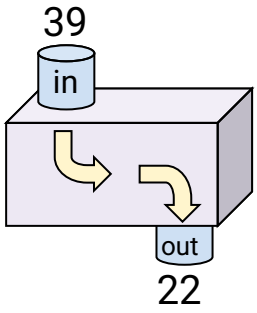

8)

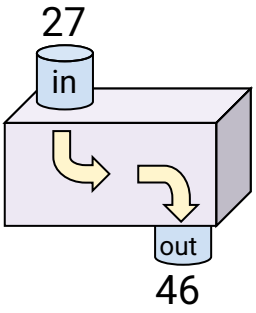

9)

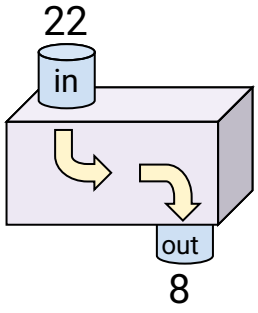

10)

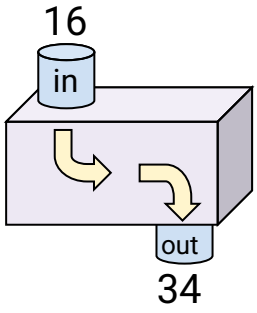

11)

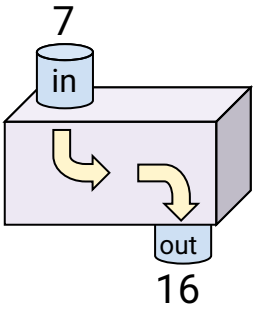

Answers

Ex. Subtract 13

1. _____
2. _____
3. _____
4. _____
5. _____
6. _____
7. _____
8. _____
9. _____
10. _____
11. _____

1-10	91	82	73	64	55	45	36	27	18	9
11	0									

Function Machines (Add & Subtract) Name: **Answer Key**

Determine the rule each function machine is using.

Ex)

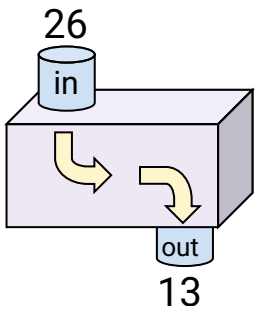

Subtract 13

1)

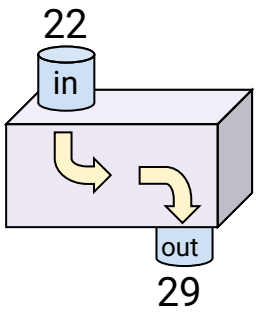

Add 7

2)

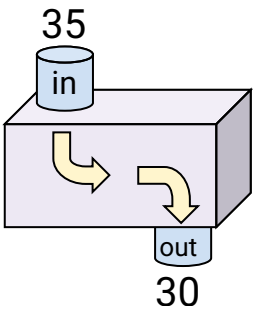

Subtract 5

3)

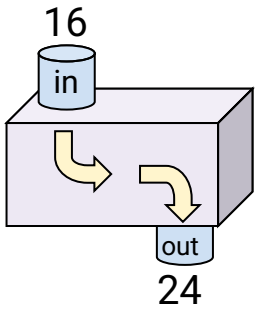

Add 8

4)

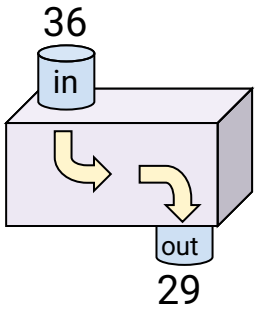

Subtract 7

5)

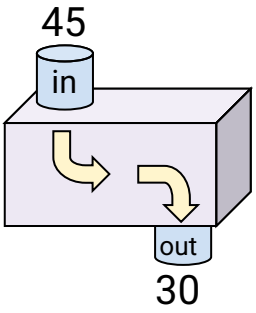

Subtract 15

6)

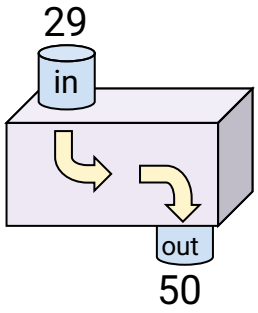

Add 21

7)

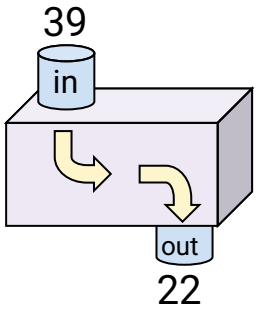

Subtract 17

8)

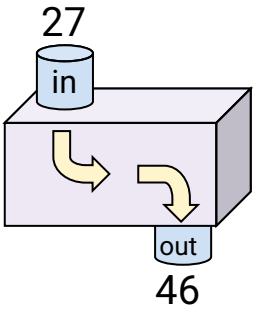

Add 19

9)

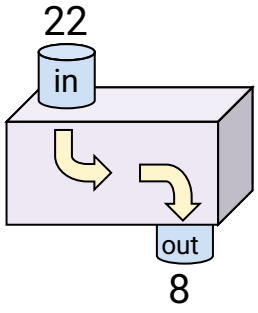

Subtract 14

10)

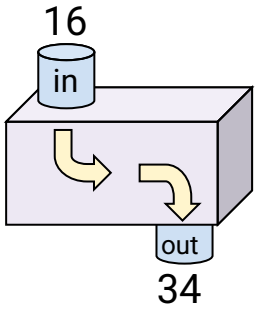

Add 18

11)

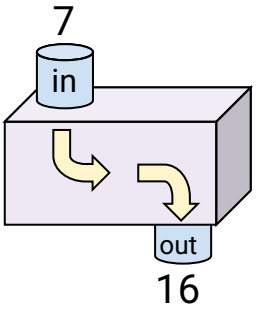

Add 9

Answers

Ex.	Subtract 13
1.	Add 7
2.	Subtract 5
3.	Add 8
4.	Subtract 7
5.	Subtract 15
6.	Add 21
7.	Subtract 17
8.	Add 19
9.	Subtract 14
10.	Add 18
11.	Add 9