Function Machines (Add & Subtract) Name:

Determine the rule each function machine is using.

Ex)

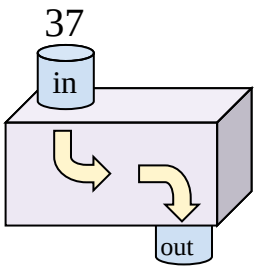

Subtract 19

1)

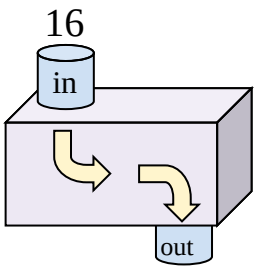

2)

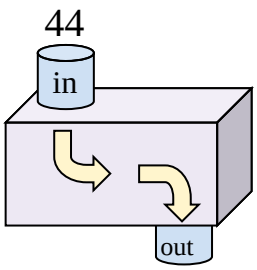

3)

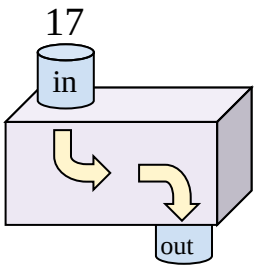

4)

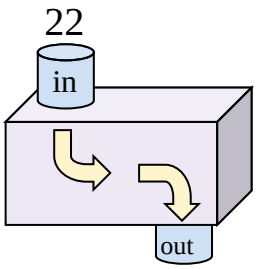

5)

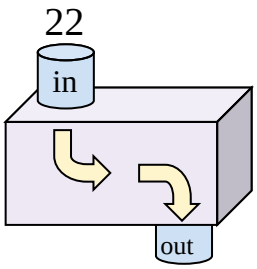

6)

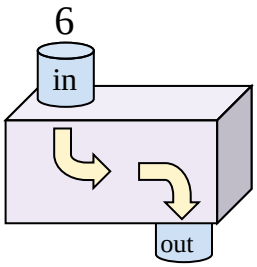

7)

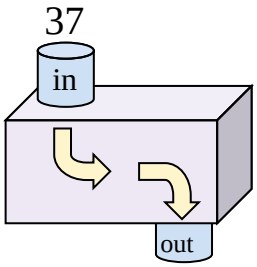

8)

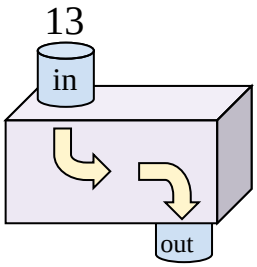

9)

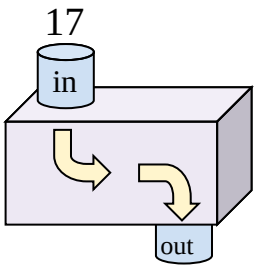

10)

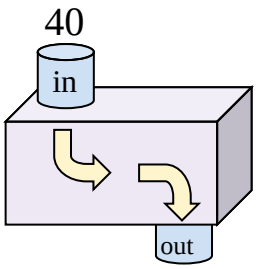

11)

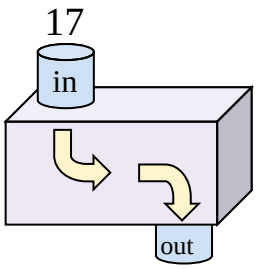

Answers

Ex. Subtract 19

1. _____
2. _____
3. _____
4. _____
5. _____
6. _____
7. _____
8. _____
9. _____
10. _____
11. _____

Function Machines (Add & Subtract) Name: **Answer Key**

Determine the rule each function machine is using.

Ex)

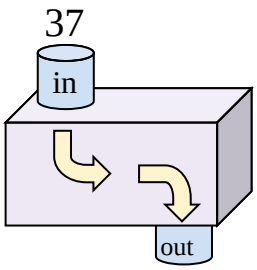

Subtract 19

1)

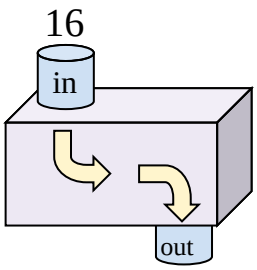

Add 10

2)

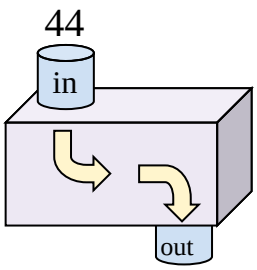

Subtract 21

3)

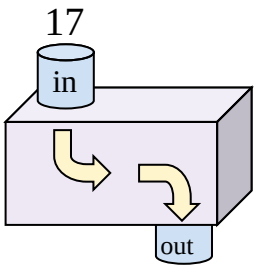

Add 28

4)

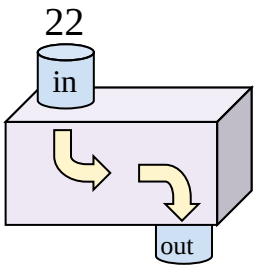

Add 22

5)

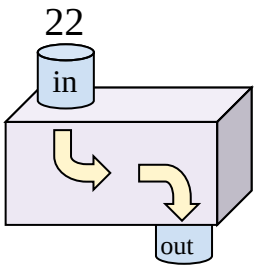

Add 28

6)

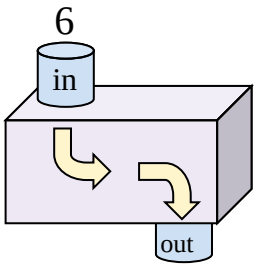

Add 26

7)

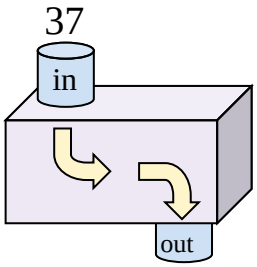

Subtract 13

8)

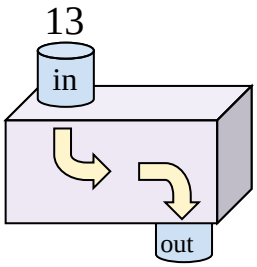

Add 24

9)

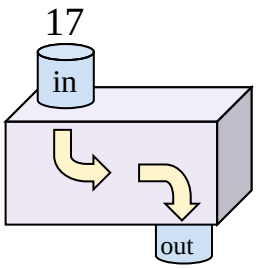

Add 14

10)

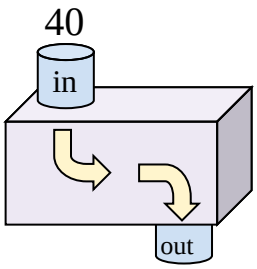

Subtract 34

11)

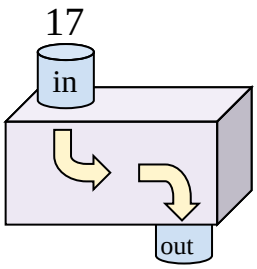

Subtract 11

Answers

Ex. Subtract 19

1. Add 10
2. Subtract 21
3. Add 28
4. Add 22
5. Add 28
6. Add 26
7. Subtract 13
8. Add 24
9. Add 14
10. Subtract 34
11. Subtract 11