Visual Place Value (Less than 20)

Name:

Fill in the blanks to find the amounts.

Ex)

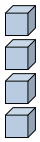

0 tens 4 ones

1)

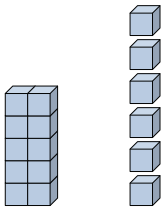

_____ tens _____ ones

2)

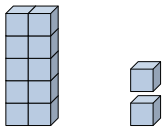

_____ tens _____ ones

3)

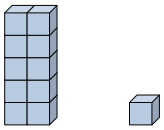

_____ tens _____ ones

4)

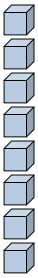

_____ tens _____ ones

5)

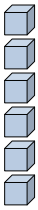

_____ tens _____ ones

6)

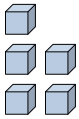

_____ tens _____ ones

7)

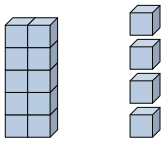

_____ tens _____ ones

8)

_____ tens _____ ones

9)

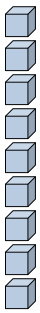

_____ tens _____ ones

10)

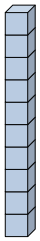

_____ tens _____ ones

11)

_____ tens _____ ones

Answers

Ex. 4

1. _____
2. _____
3. _____
4. _____
5. _____
6. _____
7. _____
8. _____
9. _____
10. _____
11. _____

Visual Place Value (Less than 20) Name: **Answer Key**

Fill in the blanks to find the amounts.

Ex)

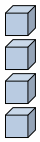

0 tens 4 ones

1)

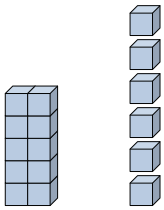

1 tens 6 ones

2)

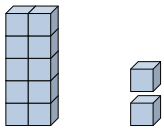

1 tens 2 ones

3)

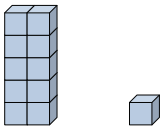

1 tens 1 ones

4)

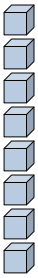

0 tens 8 ones

5)

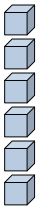

0 tens 6 ones

6)

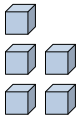

0 tens 5 ones

7)

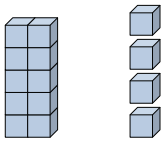

1 tens 4 ones

8)

0 tens 3 ones

9)

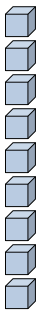

0 tens 9 ones

10)

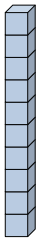

1 tens 0 ones

11)

0 tens 1 ones

Answers

Ex.	4
1.	16
2.	12
3.	11
4.	8
5.	6
6.	5
7.	14
8.	3
9.	9
10.	10
11.	1